Function Machines (Add & Subtract) Name:

**Determine the rule each function machine is using.**

**Ex)**

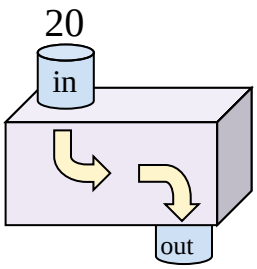


Add 28

**1)**

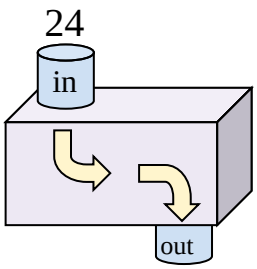


**2)**

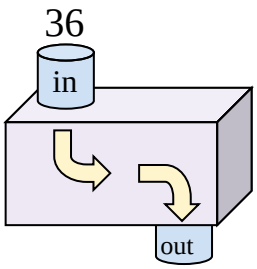


**3)**

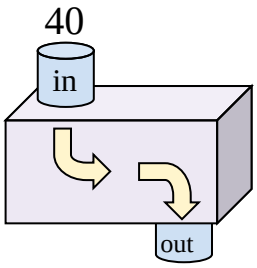


**4)**

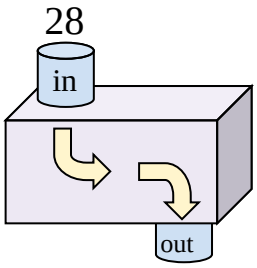


**5)**

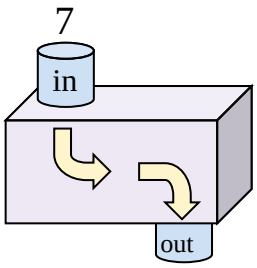


**6)**

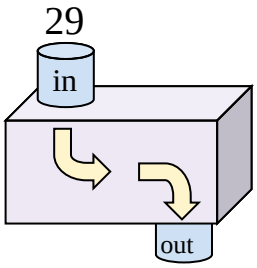


**7)**

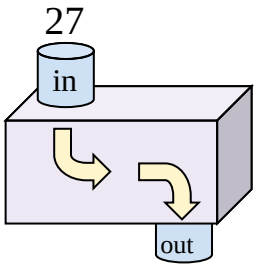


**8)**

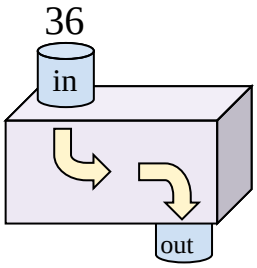


**9)**

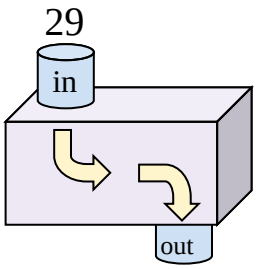


**10)**

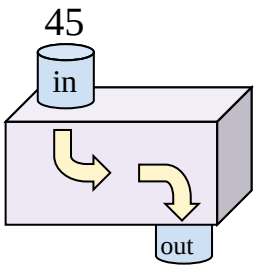


**11)**

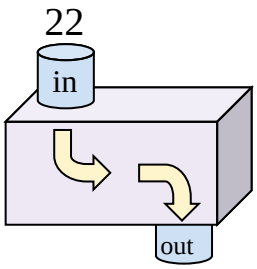


## Answers

Ex. Add 28

1.

2.

3.

4.

5.

6.

7.

8.

9.

10.

11.

Function Machines (Add & Subtract) Name: **Answer Key**

**Determine the rule each function machine is using.**

**Ex)**

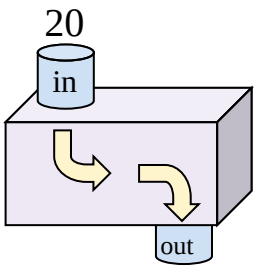


Add 28

**1)**

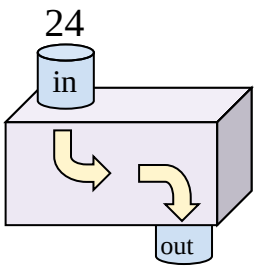


Add 11

**2)**

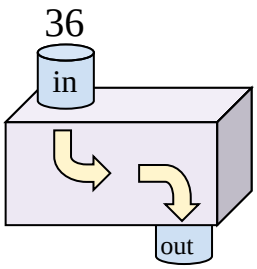


Subtract 11

**3)**

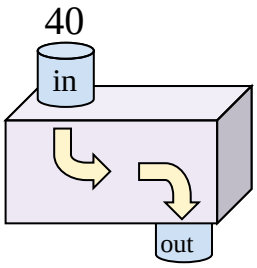


Subtract 34

**4)**

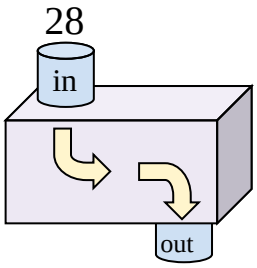


Subtract 7

**5)**

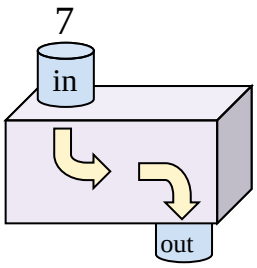


Add 11

**6)**

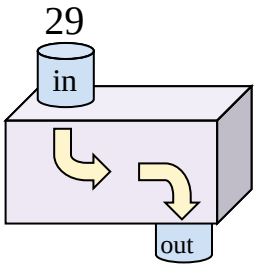


Subtract 9

**7)**

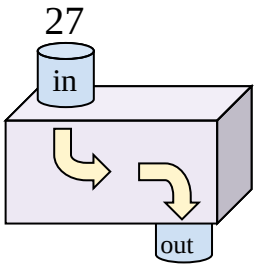


Add 21

**8)**

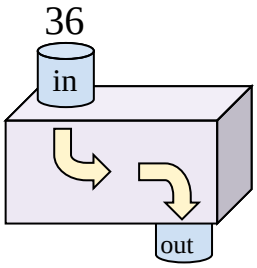


Subtract 12

**9)**

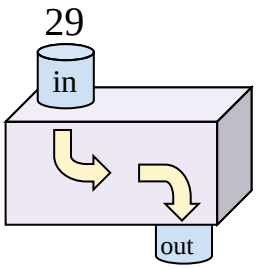


Subtract 15

**10)**

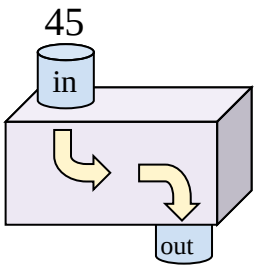


Subtract 15

**11)**

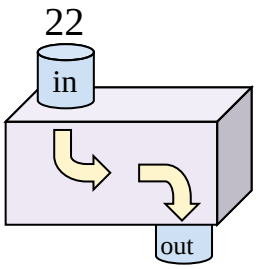


Add 16

## Answers

| | |
|---|---|
| Ex. | Add 28 |
| 1. | Add 11 |
| 2. | Subtract 11 |
| 3. | Subtract 34 |
| 4. | Subtract 7 |
| 5. | Add 11 |
| 6. | Subtract 9 |
| 7. | Add 21 |
| 8. | Subtract 12 |
| 9. | Subtract 15 |
| 10. | Subtract 15 |
| 11. | Add 16 |



| | | | | | | | | | | |
|---|---|---|---|---|---|---|---|---|---|---|
| 1-10 | 91 | 82 | 73 | 64 | 55 | 45 | 36 | 27 | 18 | 9 |
| 11 | 0 | | | | | | | | | |